All rights reserved. No part of this publication may be reproduced, distributed, or transmitted in any form or by any means, electronic, mechanical, photocopying, recording or otherwise, or stored in any retrieval system of any nature without the permission of cracku.in, application for which shall be made to support@cracku.in

Downloaded from cracku.in

SSC CHSL 24th May 2022 Shift-2

English Language

1. **Select the INCORRECTLY spelt word.**

A Efficient

B Feeld

C Committee

D Layer

Answer: B

2. **Select the option that will improve the underlined part of the given sentence.**
One's family plays a very major role to continue the trends and age-old traditions.

A significant role in enduring the trends

B passive role in making the trends

C docile part in enduring trends

D futile part in making trends

Answer: A

3. **Select the most appropriate option to fill in the blank.**
A wise king's wisdom _____the land like the sun.

A dims

B darkens

C spreads

D illuminates

Answer: D

4. **Select the most appropriate option that can substitute the underlined segment in the given sentence.**
He dreams big than his friends.

A most big

B biggest

C more big

D bigger

Answer: D

SSC CHSL Free Mock Test

Downloaded from cracku.in

5. **Select the most appropriate ANTONYM of the highlighted word.**
The malice he developed for all caused a lot of damage.

A oppression

B grace

C sympathy

D avarice

Answer: C

6. **Select the option that expresses the given sentence in passive voice.**
Kiara will sign all the documents tomorrow.

A All the documents will be signed by Kiara tomorrow.

B Tomorrow Kiara will be signed by all the documents.

C Kiara would have been signed tomorrow by all the documents.

D Kiara was to be signed by tomorrow for all the documents.

Answer: A

7. **Select the most appropriate synonym of the given word.**
Abundant

A Plentiful

B Scarce

C Abysmal

D Ephemeral

Answer: A

SSC CHSL Prevoius Papers (DOWNLOAD PDF)

8. **Select the denotation of the highlighted word.**
The guile of the businessman is well known to his contemporaries.

A Slyness

B Gentleness

C Courage

D Shyness

Answer: A

9. **Select the most appropriate synonym of the word given in the brackets to fill in the blank.**
The university team won the match in the end with a _____ (cunning) move.

A quick

Downloaded from cracku.in

B slick

C random

D brilliant

Answer: B

10. **Select the most appropriate ANTONYM of the underlined word in the following sentence.**
I felt terribly <u>jaded</u> after working all weekend.

A spent

B glutted

C vigorous

D refreshed

Answer: D

SSC CGL Previous Papers (DOWNLOAD PDF)

11. **Select the most appropriate meaning of the idiom given in bold in the following sentence.**
At supper, everyone was in high spirits.

A nervous

B cheerful

C drunk

D anxious

Answer: B

12. **Select the option that can be used as a one-word substitute for the given group of words.**
A small organised dissenting group within a larger one

A Set

B Band

C Cluster

D Faction

Answer: D

13. **Select the option that can be used as a one-word substitute for the given group of words.**
Unable to speak distinctly or express oneself clearly

A Inane

B Inapt

C Inarticulate

D Inarch

Answer: C

Downloaded from cracku.in

14. **Select the INCORRECTLY spelt word.**

A Martinet

B Phlegmatic

C Congenital

D Occular

Answer: D

15. **Select the most appropriate meaning of the given idiom.**
Call upon

A To adjust

B To stop

C To order

D To follow

Answer: C

16. **Select the most appropriate meaning of the given idiom.**
Gear up for

A Put on

B Pass into

C Start off

D Get ready for

Answer: D

SSC CHSL Important Questions and Answers (Download PDF)

17. **Select the correctly spelt word to fill in the blank.**
The people from sub-continent are very _____.

A supersctitious

B superstitios

C superstitious

D supersticious

Answer: C

18. **Select the option that expresses the given sentence in passive voice.**
The boy kicked the ball high into the air.

Downloaded from cracku.in

A The boy kicks the ball high into the air.

B The ball was kicked high into the air by the boy.

C The boy had kicked the ball high into the air.

D The ball will be kicked high into the air by the boy

Answer: B

19. **Select the option that expresses the given sentence in active voice.**
A trip to the village temple was made by Bhavani yesterday.

A Bhavani is going to make a trip to the temple today.

B Bhavani was going to make a trip to the temple yesterday.

C Bhavani made a trip to the village temple yesterday.

D Bhavani tripped to the village temple yesterday.

Answer: C

SSC CHSL Study Material

20. **Sentences of a paragraph are given below in jumbled order. Arrange the sentences in the correct order to form a meaningful and coherent paragraph.**
A. The first time that I was seated behind a curtain in a dining car, I felt as if the curtain had been dropped on my selfhood and could never adjust to the separate waiting rooms, separate eating places, separate rest rooms, partly because the separate was always unequal, and partly because the very idea of separation did something to my sense of dignity and self-respect.
B. One Sunday, we went to church in Simsbury, and we were the only Negroes there and on Sunday mornings I was the religious leader and spoke on any text I wanted to 107 boys.
C. Just before going to college I went to Simsbury, Connecticut, and worked for a whole summer on a tobacco farm to earn a little school money to supplement what my parents were doing.
D. After that summer in Connecticut, it was a bitter feeling going back to segregation and it was hard to understand why I could ride wherever I pleased on the train from New York to Washington and then had to change to a Jim Crow car at the nation's capital in order to continue the trip to Atlanta.

A CBDA

B ADBC

C CDBA

D BCDA

Answer: A

Instructions [21 - 25]

In the following passage, some words have been deleted. Read the passage carefully and select the most appropriate option to fill in each blank.

Novelists when they write novels tend to take an almost god-like attitude (1) _____ their subject, pretending to a total comprehension of the story, a man's life, (2) _____ they can therefore recount as God Himself might, nothing standing between them and the naked truth, the entire story meaningful in (3) _____ detail. I am as little able to do this as the novelist is, even though my story is more important to me than any novelist's is to him - for this is my story; it is the story of a man, not of an invented, or possible, or idealised or otherwise (4) _____ figure, but of a unique (5) _____ of flesh and blood.

21. **Select the most appropriate option to fill in blank number 1.**

Downloaded from cracku.in

A despite

B towards

C under

D through

Answer: B

22. **Select the most appropriate option to fill in blank number 2.**

A whose

B who

C whom

D which

Answer: D

SSC CHSL Free App

23. **Select the most appropriate option to fill in blank number 3.**

A self

B last

C present

D every

Answer: D

24. **Select the most appropriate option to fill in blank number 4.**

A absent

B ordinary

C profuse

D callous

Answer: A

25. **Select the most appropriate option to fill in blank number 5.**

A stance

B being

C cripple

D organism

Answer: B

Downloaded from cracku.in

General Intelligence

26. **Select the option figure in which the given figure (X) is embedded as its part.**

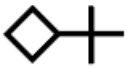

(X)

A 

B

C 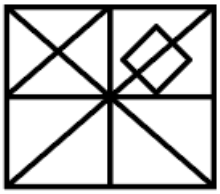

D 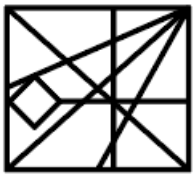

Answer: D

Free SSC Study Material (18,000 Solved Questions)

27. **Select the option that is related to the fifth term in the same way as the second term is related to the first term and the fourth term is related to the third term.**
AMOUNT : MOUNT :: BRIDGE : RIDGE :: BRIGHT : ?

A SIGHT

B RIGHT

C KIGHT

D NIGHT

Answer: B

28. **The second number in the given number-pairs is obtained by performing certain mathematical operation(s) on the first number. The same operation(s) are followed in all the number-pairs EXCEPT one. Find that odd number-pair.**

Downloaded from cracku.in

A 225 : 18

B 256 : 19

C 196 : 17

D 169 : 14

Answer: D

29. **Select the option that represents the correct order of the given words as they would appear in an English dictionary.**
1.Negotiation
2.Negate
3.Networking
4.Negligible
5.Newspaper

A 2,1,4,3,5

B 4,1,2,3,5

C 4,2,1,3,5

D 2,4,1,3,5

Answer: D

1500+ Very Important Free SSC Solved Questions

30. **Select the Venn diagram that best represents the relationship between the following classes.**
Bed, Bedroom, House

A 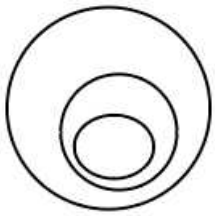

B

C 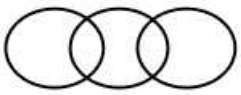

D 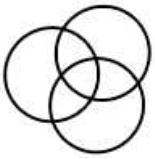

Answer: A

31. **In a certain code language, 'SAMPLE' is written as 'RYJLGY' and 'MAPLE' is written as 'LYMHZ'.How will 'PEOPLE' be written in that language?**

Downloaded from cracku.in

A OBGLGY

B OCLLGY

C OCLLGL

D GCLLGY

Answer: B

32. **Select the correct combination of mathematical signs to replace the * signs and to balance the given equation.**
42*4*69*3*29*60*5

A $+, =, -, \times, \div, -$

B $-, =, \times, +, \times, \div$

C $+, \div, =, -, \times, +$

D $\times, -, =, \times, +, \div$

Answer: D

SSC Exam Update Videos & Free Study Material (YouTube Channel)

33. **Select the correct mirror image of the given combination when the mirror is placed at MN as shown.**

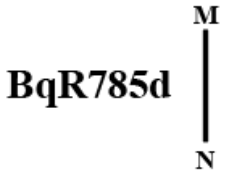

A

B 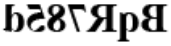

C

D 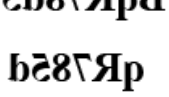

Answer: B

34. **Select the correct mirror image of the given combination when the mirror is placed at MN as shown.**

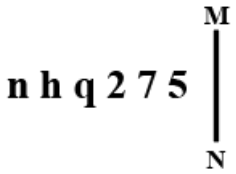

A 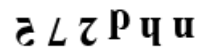

B

C

D

Downloaded from cracku.in

Answer: C

35. **Select the correct mirror image of the given combination when the mirror is placed at MN as shown.**

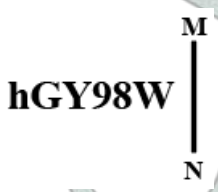

A

B

C

D

Answer: B

Latest Job Updates on Telegram - Join here

36. **Select the correct combination of mathematical signs to sequentially replace the * signs and to balance the given equation.**
25*5*10*2*8*44

A $-, +, \div, \times, =$

B $\div, \times, -, +, =$

C $\times, \div, -, +, =$

D $\div, \times, +, -, =$

Answer: D

37. **Select the correct combination of mathematical signs to sequentially replace the * signs and to balance the given equation.**
16*4*8*10*2*24

A $\div, -, +, =$

B $\div, \times, -, +, =$

C $\div, +, \times, -, =$

D $-, \div, +, \times, =$

Answer: B

38. **Select the correct combination of mathematical signs to replace the * signs and to balance the given equation.**
91*15*5*18*37

A $-, =, +, -$

B $=, \div, \times, +$

C $+, -, =, \times$

Downloaded from cracku.in

D $+, =, \times, -$

Answer: B

Join SSC Daily Quiz Telegram Group

39. **Select the option that represents the correct order of the given words as they would appear in an English dictionary.**
1.Dish
2.Disease
3.Discuss
4.Disjoin
5.Disgrace

A 2, 3, 1, 5, 4

B 3, 2, 1, 5, 4

C 3, 2, 5, 1, 4

D 2, 3, 5, 1, 4

Answer: C

40. **Select the option that is related to the fifth term in the same way as the second term is related to the first term and the fourth term is related to the third term.**
DETAILS : TEDASLI :: EMPATHY : PMEAYHT :: FORMULA : ?

A RFMALUO

B RFOMALU

C ALUMROF

D ROFMALU

Answer: D

41. **Select the correct combination of mathematical signs to replace the * signs and to balance the given equation.**
37*3*21*79*18*4*19

A $\times, +, -, =, \times, -$

B $+, \times, -, =, +, -$

C $-, -, =, \times, +, \div$

D $=, -, \times, +, -, \times$

Answer: A

42. **How many squares are there in the given figure?**

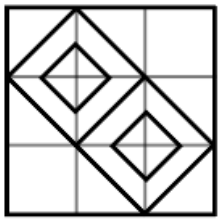

Downloaded from cracku.in

A 12

B 9

C 24

D 18

Answer: D

43. **Select the correct combination of mathematical signs to sequentially replace the * signs and balance the given equation.**
57*35*44*11*13*74

A $\times, +, \div, -, =$

B $+, -, \times, \div, =$

C $+, -, \div, \times, =$

D $-, +, \div, \times, =$

Answer: D

44. **Select the option that represents the letters that, when placed from left to right in the blanks, will complete the letter series.**
S _ O Z Q T L O _ Q U _ O _ Q V L O Z _

A L Z L Z Q

B L Z Q Z L

C Z L Z Q L

D Z L Q L Z

Answer: A

SSC CHSL Free Mock Test

45. **Select the correct combination of mathematical signs to sequentially replace the * signs and to balance the given equation.**
25*5*10*2*8*60

A $\div, \times, +, -, =$

B $\times, \div, -, +, =$

C $-, +, \div, \times, =$

D $\div, \times, -, +, =$

Answer: C

46. **In a certain code language, 'WORTH' is written as 'ZRRWK' and 'TRACK' is written as 'WUAFN'. How will 'FAITH' be written in that language?**

A JDIWK

B HDIWL

Downloaded from cracku.in

C KDIVK

D IDIWK

Answer: D

47. **Which letter-cluster will replace the question mark (?) to complete the given series?**
DRBZ, ABKX, ?, UVCT, RFLR

A YDBE

B YDMC

C XLTV

D XUIV

Answer: C

SSC CHSL Prevoius Papers (DOWNLOAD PDF)

48. **Which of the following numbers will replace the question mark (?) in the given series?**
286,303,320,371,422,507,?

A 592

B 582

C 626

D 602

Answer: A

49. **Select the option that is related to the fifth number in the same way as the second number is related to the first number and the fourth number is related to the third number.**
52 : 5 :: 100 : 7 :: 164 : ?

A 9

B 8

C 11

D 7

Answer: A

50. **Select the correct mirror image of the given combination when the mirror is placed at 'PQ' as shown.**

A 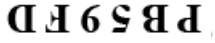

Downloaded from cracku.in

B 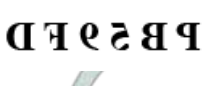

C

D

Answer: B

SSC CGL Previous Papers (DOWNLOAD PDF)

Quantitative Aptitude

51. **Inside a triangle ABC, a straight line parallel to BC intersects AB and AC at the points P and Q, respectively. If AB = 6PB, then PQ : BC is _____.**

A 5 : 4

B 2 : 6

C 5 : 6

D 3 : 4

Answer: C

SSC CGL Free Mock Test (Latest Pattern)

52. **Which of the following numbers is divisible by 7?**

A 3661

B 3915

C 3659

D 3739

Answer: A

53. **Find the approximate percentage increase in sales from 2002 to 2003?**

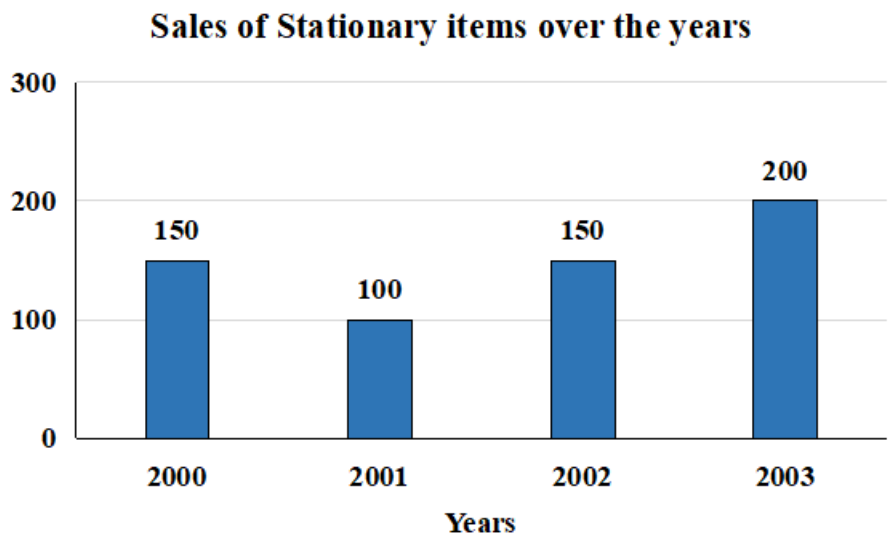

Downloaded from cracku.in

A 24.45%

B 19.4%

C 54%

D 33.3%

Answer: D

54. **If a + b = 12 and ab = 35, find the value of $a^4 + b^4 - 10^3$?**

A 1226

B 2026

C 2226

D 2126

Answer: B

SSC CHSL Important Questions and Answers (Download PDF)

55. **The heights of 48 students of a class are shown in the following table.**

Height (in cm)	No. of students
up to 150	12
up to 155	16
up to 160	18
up to 165	33
up to 170	48

What is the percentage of students whose height is more than 160 cm?

A 33.3%

B 37.5%

C 66.6%

D 62.5%

Answer: D

56. **The population of a village is 9,000. If the annual birth rate is 12.5% and the annual death rate is 2.5%, calculate the population after three years.**

A 11979

B 10959

C 12256

D 10755

Answer: A

Downloaded from cracku.in

57. **A man can row 5 km/h in still water. If the speed of the current is 2.5 km/h, it takes 4 hours more in upstream than in the downstream for the same distance. The distance is:**

A 15 km

B 7.5 km

C 12 km

D 10.5 km

Answer: A

SSC CHSL Study Material

58. **Simplify:**
$3p - [3p - p + q - \{3p - (-q - p)\}]$

A 2p + 2q

B 3p - q

C 3p + 2q

D p + 2q

Answer: A

59. **If base radius and height of a cylinder are 4 cm and 5 cm, respectively, then find the curved surface area of the cylinder [use $\pi = 3.14$].**

A 125.6 cm^2

B 129.8 cm^2

C 119.6 cm^2

D 138 cm^2

Answer: A

60. **Find the volume of a hemisphere whose diameter is 6 cm. (Take $\pi = \frac{22}{7}$)**

A $36\pi\ cm^3$

B $144\pi\ cm^3$

C $48\pi\ cm^3$

D $18\pi\ cm^3$

Answer: D

SSC CHSL Free App

61. **A shopkeeper marks up his goods by 30% and then gives a discount of 10% on the marked price. Apart from this, he uses a faulty balance which reads 1 kg for 870 g. What is his net profit percentage?**

Downloaded from cracku.in

A 38.24%

B 34.84%

C 34.48%

D 38.42%

Answer: C

62. **A trader marks his goods at 45% above the cost price. He offers a discount of 21% to his customers. What is his percentage profit (rounded off to the nearest integer)?**

A 14%

B 15%

C 18%

D 12%

Answer: B

63. **A man P purchased a land for ₹4,32,000 on the outskirts of a city. Due to some reason, its value depreciated at 25% per annum and he sold it to Q after 2 years. At this time, the city expanded and new projects of infrastructures started coming up. As a result of the expansion, there was an appreciation of real estate prices at the rate of 50%. What would be the value (in ₹) of the land after 2 years, from the time Q bought the land from P?**

A ₹5,46,750

B ₹6,05,070

C ₹5,76,450

D ₹5,57,450

Answer: A

Daily Free SSC Practice Set

64. **If the volume of a cube is 27 m^{3}, find its surface area (in m2) .**

A 24

B 54

C 27

D 9

Answer: B

65. **A new mobile is introduced into the market and is marked at 25% above its original cost price. What discount should be given on the marked price to gain a profit of 20%?**

A 5%

B 10%

Downloaded from cracku.in

C 4%

D 2.50%

Answer: C

66. **The value of** $11 \div [1 + 1 \div \{1 + 1 \div (1 + 1 \div 3)\}]$ **is:**

A 11

B 1

C 9

D 7

Answer: D

Free SSC Study Material (18,000 Solved Questions)

67. **If 2a + b = 10, 2ab = 9, and 2a > b, then find the value of 2a - b.**

A 12

B 6

C 8

D 10

Answer: C

68. **A and B together can do a piece of work in 12 days, while A alone can complete the same work in 18 days. How long will B alone take to complete the work?**

A 36 days

B 6 days

C 24 days

D 12 days

Answer: A

69. **The table below gives the numbers of seats own in the local body elections in a state by different political parties in the years 2019 and 2014 .**

Name of the Party	Result in 2019	Result in 2014
AGP	303	282
Con Party	52	43
CMK	23	0
AICT	22	34
Kanta Dal	16	2
Shiv Party	18	18

Find the ratio of the total number of seats won by Con party in 2014, Kanta Dal in 2019, and the Shiv Party in 2019 taken together to the number of seats won by AGP in 2014 .

Downloaded from cracku.in

A 77 : 282

B 145 : 77

C 283 : 77

D 77 : 141

Answer: A

1500+ Very Important Free SSC Solved Questions

70. **Find the mean proportion of 3 and 27.**

A 6

B 5

C 10

D 9

Answer: D

71. **In an election between two candidates, Ravi gets 65% of total valid votes. If total votes were 6000, what is the number of valid votes that the other candidate Sushil gets, if 25% of total votes were invalid?**

A 1625

B 1575

C 1525

D 1775

Answer: B

72. **Shovik purchases two types of sugar: the first type at Rs.45 per kg and the second type at Rs.80 per kg. In what ratio should Shovik blend the first type of sugar with the second type so that, by selling each kg of the blended sugar at Rs.72 per kg, he makes a profit of 20%?**

A 4 : 3

B 3 : 4

C 5 : 4

D 3 : 2

Answer: A

SSC Exam Update Videos & Free Study Material (YouTube Channel)

73. **Find the average of the following data :**
1, 2, 3, 5, 17, 21 and 28

A 12

Downloaded from cracku.in

B 9

C 13

D 11

Answer: D

74. **$$\Sin$$ (−A) = ?**

A $$\Sin$$ A

B $$\Cos$$ A

C $$−\Cos$$ A

D $$−\Sin$$ A

Answer: D

75. **In a test, the average score of 50 students is 66. Out of the total students, 40% are girls and the rest are boys. The average score of the boys is 20% less than that of the girls. What is the average score of the girls?**

A 80

B 65

C 75

D 70

Answer: C

Latest Job Updates on Telegram - Join here

General Awareness

76. **Which of the following Marathi writers was the author of the autobiography 'Majya Jalmachi Chittarkatha'?**

A Sunita Deshpande

B Shivaji Sawant

C Kusumagraj

D Shantabai Krushnaji Kamble

Answer: D

Join SSC Daily Quiz Telegram Group

77. **Who among the following won Arjuna Award 2021 in Kabaddi discipline?**

A Sandeep Narwal

B Tejaswini Bai V

C Ajay Thakur

Downloaded from cracku.in

D Jasvir Singh

Answer: A

78. **Which of the following is the youngest percussionist to be awarded Padma Shri and Padma Bhushan awards by the Government of India?**

A Sivamani

B T H Vinakram

C Zakir Hussain

D Sarvar Sabri

Answer: C

79. **What is the position of non-metals in the periodic table?**

A Bottom of the table

B Top period

C On the right side

D On the left side

Answer: C

80. **When was the Sri Shanmukhananda National Eminence Award set up?**

A 2000

B 2002

C 2003

D 2001

Answer: B

81. **Who among the following Indian classical musicians was the very first to be presented with the Bharat Ratna, India's highest civilian honour?**

A Madurai Shanmukhavadivu Subbulakshmi

B Bismillah Khan

C Lata Mangeshkar

D Ravi Shankar

Answer: A

82. **Which of the following has launched the 'DBT-Star College Mentorship Programme' in November 2021?**

A Ministry of Heavy Industries and Public Enterprises

B Ministry of Tourism

Downloaded from cracku.in

C Ministry of Science and Technology

D Ministry of Shipping

Answer: C

SSC CHSL Free Mock Test

83. **Isopentane, also called _____, is a branched-chain saturated hydrocarbon with the chemical formula $$C_{5}H_{12}$$.**

A butadiene

B dimethylbutane

C 2-methylbutane

D isobutane

Answer: C

84. **Recently, some mail channels have been introduced to facilitate quick delivery of mail in large towns and cities in India. Which of the following is NOT a part of these mail channels?**

A Metro Channel

B State Channel

C Rajdhani Channel

D Green Channel

Answer: B

85. **Which of the following books is NOT written by Arundhati Roy?**

A Private Life of An Indian Prince

B The God of Small Things

C Capitalism

D An Ordinary Person's Guide to Empire

Answer: A

SSC CHSL Prevoius Papers (DOWNLOAD PDF)

86. **Padma Shri awardee Gopal Prasad Dubey was awarded for his contribution to which of the following dances?**

A Panthi

B Mohiniyattam

C Chhau

D Sattriya

Answer: C

Downloaded from cracku.in

87. **Which of the following countries will jointly organise the FIH Women's Hockey World Cup from 1 to 17 July 2022?**

A Spain and Netherlands

B Spain and Germany

C India and Pakistan

D India and Sri Lanka

Answer: A

88. **Usually, which year of a series of years in an economic index is called the base year?**

A First year

B Last year

C Twentieth year

D Tenth year

Answer: A

SSC CGL Previous Papers (DOWNLOAD PDF)

89. **Shamshad begum, one of the first women to sing playback for Hindi movies, was conferred with the prestigious OP Nayyar Award for her contribution to Hindi film Music in the year _____.**

A 2012

B 2001

C 2005

D 2009

Answer: D

90. **Which cell theory proved that the quasi-fluid nature of lipid enables lateral movement of proteins within the overall bilayer?**

A Model of Golgi bodies

B Cell theory

C Fluid mosaic model

D Vacuole theory

Answer: C

91. **Meenakshi Srinivasan received the Ustad Bismillah Khan Yuva Puraskar 2011 for which of the following dance forms?**

A Sattriya

B Kuchipudi

C Mohiniyattam

Downloaded from cracku.in

D Bharatanatyam

Answer: D

SSC CGL Free Mock Test (Latest Pattern)

92. **Identify the terrestrial planet from among the following.**

A Neptune

B Mercury

C Uranus

D Jupiter

Answer: B

93. **Identify the correct statement in relation toampere.**

A One ampere is constituted by the flow of one coulomb of charge per minute

B One ampere is constituted by the flow of one coulomb of charge per second

C One ampere is constituted by the flow of two coulomb of charge per second

D One ampere is constituted by the flow of half coulomb of charge per second

Answer: B

94. **Dr. Sunanda Nair is recognised as a _____ performer, teacher, and proponent.**

A Kathakali

B Kathak

C Kuchipudi

D Mohiniyattam

Answer: D

SSC CHSL Important Questions and Answers (Download PDF)

95. **'The God of Small Things', a winner of the 1997 Booker Prize, is the debut novel of which of the following Indian writers?**

A Arundhati Roy

B Jhumpa Lahiri

C Kiran Desai

D Anita Desai

Answer: A

96. **The Health Minister relaunched the intensified version 4.0 of the largest global inoculation drive in February 2022. What is the name of this Mission which covers crores of pregnant women and children?**

Downloaded from cracku.in

A Mission Shakti

B Mission Suraksha

C Mission Indradhanush

D Mission Arogya

Answer: C

97. **Where is sodium located on the periodic table?**

A Bottom of the table

B On the left side

C Top period

D On the right side

Answer: B

SSC CHSL Study Material

98. **In the absence of the Speaker and the Deputy Speaker of Lok Sabha, who presides the joint sitting of the two houses of Parliament?**

A Any senior member of Rajya Sabha

B Any senior member of Lok Sabha

C Deputy Chairman of Rajya Sabha

D Chairman of Rajya Sabha

Answer: C

99. **Name the track and field event shown in the picture below.**

image

A Discuss throw

B Hammer throw

C Putting the shot

D Javelin throw

Answer: D

100. **Who is the first Indian musician to win the Oscar award for Best Original Score?**

A A.R. Rahman

B Bhanu Athaiya

C Mehboob Khan

D Resul Pookutty

Downloaded from cracku.in

Answer: A

SSC CHSL Free App

SSC CHSL Free Mock Test

SSC CHSL Prevoius Papers (DOWNLOAD PDF)

SSC CGL Previous Papers (DOWNLOAD PDF)

SSC CGL Free Mock Test (Latest Pattern)

SSC CHSL Important Questions and Answers (Download PDF)

SSC CHSL Study Material

SSC CHSL Free App

Daily Free SSC Practice Set

Free SSC Study Material (18,000 Solved Questions)

1500+ Very Important Free SSC Solved Questions

SSC Exam Update Videos & Free Study Material (YouTube Channel)

Latest Job Updates on Telegram - Join here

Join SSC Daily Quiz Telegram Group

Downloaded from cracku.in